Area

1 On the grids below, each square measures 1 cm^2.

Find the area of each shaded shape.



cm²



cm²



cm²



cm²

2 marks

2 The diagram below shows Janet's new patio.

Each square on the patio is 1 m^2.
What is the area of the patio?

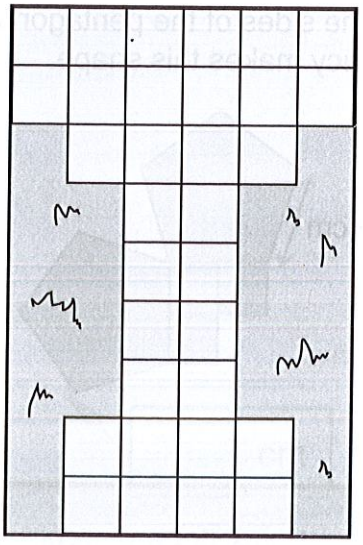

m²

1 mark

Area

3 Here is a centimetre square grid.

Draw a shape with an area of 11 cm^2.



1 mark

4 Calculate the area of the shaded shapes shown on the grids below.

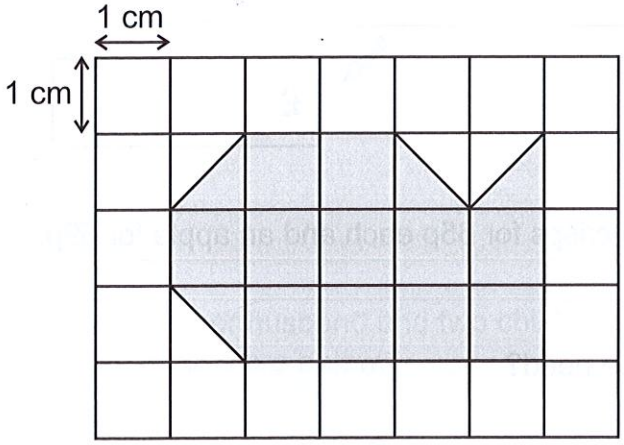

cm^2

1 mark

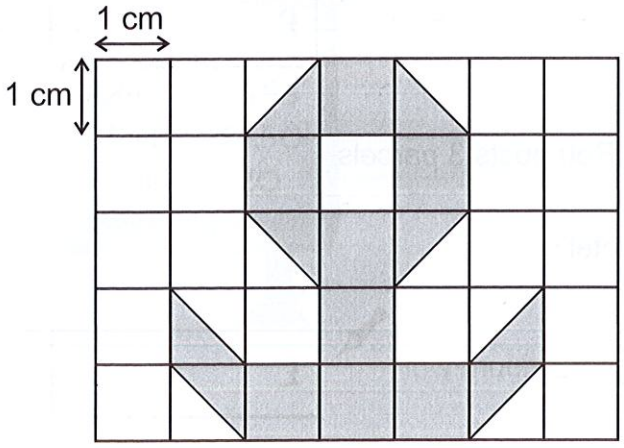

cm^2

1 mark

"I can find the areas of shapes by counting squares."